Fractions Worksheet | Halves, thirds, quarters, sixths and eighths

Instructions: Under each shape, write whether it's divided into **halves**, **thirds**, **quarters**, **sixths**, or **eighths**.



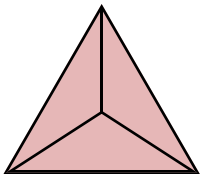

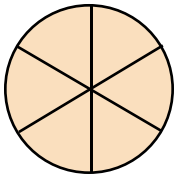

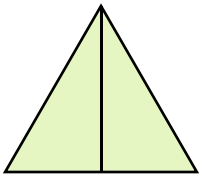



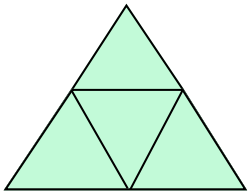

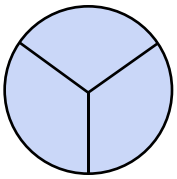



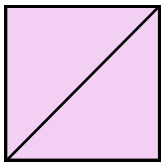

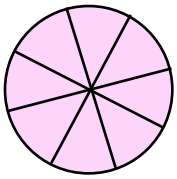



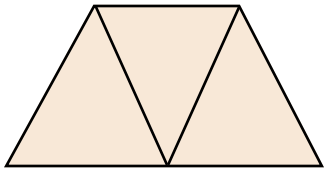

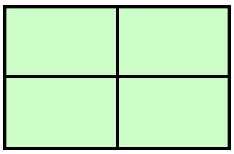

 © ClassWeekly.com